Name: _____

Minecraft Angle Investigation.

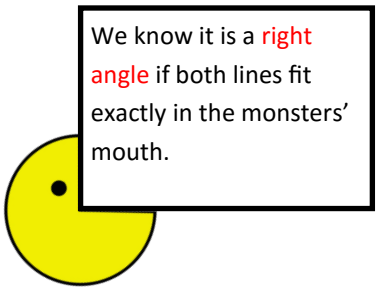

We know it is a right angle if both lines fit exactly in the monsters' mouth.

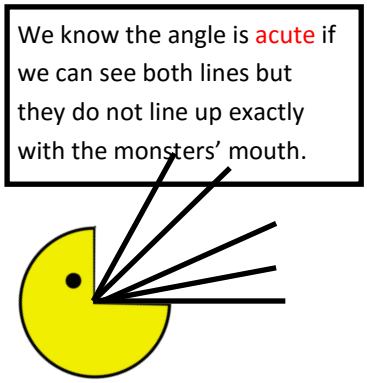

We know the angle is acute if we can see both lines but they do not line up exactly with the monsters' mouth.

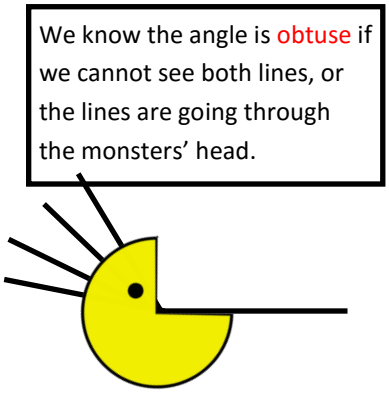

We know the angle is obtuse if we cannot see both lines, or the lines are going through the monsters' head.

Use your right angle creature to find the angles in these Minecraft characters.



How many right angles does Steve have?



How many right angles on this 'Diamond Sword' ?







Extension: What other angles can you find on these characters?

Which character has the most acute angles?

Which character has the most obtuse angles?